Name: _____

sums to 5

Ladybug Addition

Write an addition problem to show the dots. Find the answer.







Name: _____

sums to 10

Ladybug Addition

Write an addition problem to show the dots. Find the answer.





Name: _____

numbers to 5

Ladybug Subtraction

Write a subtraction problem to show the dots. Find the answer.











Name: _____

numbers to 10

Ladybug Subtraction

Write a subtraction problem to show the dots. Find the answer.